24 + 7 = 31



Sherlyn saw 24 frogs. Marissa saw 7 more frogs. How many frogs are in all?

8 + □ = 16

8 dogs ran away. There are 16 dogs altogether. How many are still there?

24 + 7 = 31



Sherin saw 24 frogs. Marissa saw 7 more frogs. How muhy frogs are in all?

8 + □ = 16

8 dog ran away there are 16 dogs altogether How many are still there?

Jordan

Sherlyn saw 24 frogs. Marisse saw 7 more frogs. How many frogs are in all?

$24+7=\boxed{31}$

8 dogs rar away. ther are 16 dogs altogether. How many are still there?

$8+\boxed{8}=16$

24 + 7 = 31



Sherily saw 24 frogs. Marissa saw 7 more frogs. How many frogs are in all?

8 + □ = 16

8 dogs ran away. There are 16 dogs all together. How many are still there?

Marsena

1

$24 + 7 = \boxed{31}$

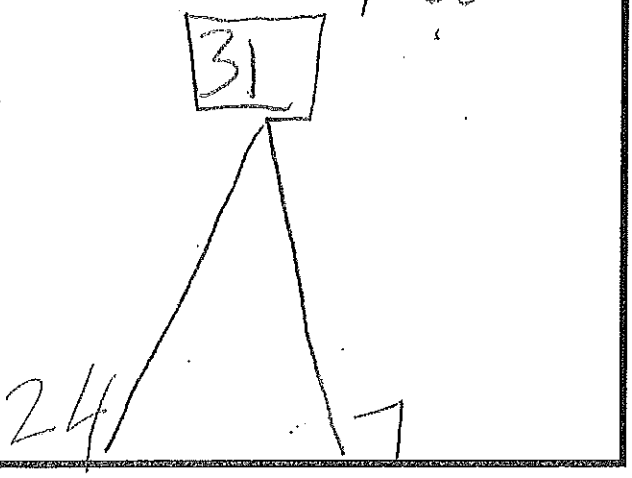

Sherlyn saw 24 frog Marissa saw 7 more frog How many frog are in all

4

$8 + \square = 16$

8 dogs ran away. Ther are 16 dog all toger. How many are still there?

$24 + 7 = \boxed{31}$

11 00 00 | 0 00 00 00

24 7

Sherx nsd w
24 frogs
Marissa sd w
7 more frogs
how many
frogs are
In All?

$8 + \boxed{8} = 16$

8 Dogs
ran away.
there
are 16 dogs
All together
how many
are still there?