15 + 7 = 29



Marissa saw 15 rigas and Allison saw 7 more. How many in all?

□ + 9 = 12

Allison saw some owls Tyler saw 9 foxes

24+7=□

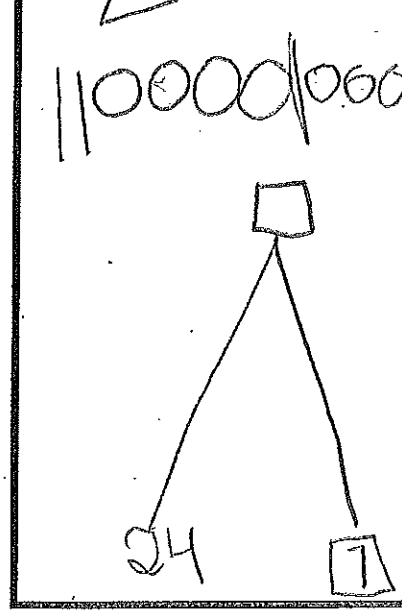

Sherlyn Saw 24 frog. Marissa Saw 7more frog How many frog are in all?



8 dog ran away There are 16 dogs alltogether How many are still there?

$15 + 7 = \boxed{22}$

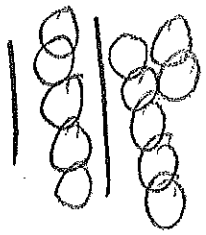

I saw snow men. 7 more snow men came. How many are all together?

$\boxed{3} + 9 = 12$

I saw 9 baskets. Kimbeck saw 12 baskets on the street? We abbet 3 more stars a the yard

kimberly

$24 + 7 = \boxed{31}$

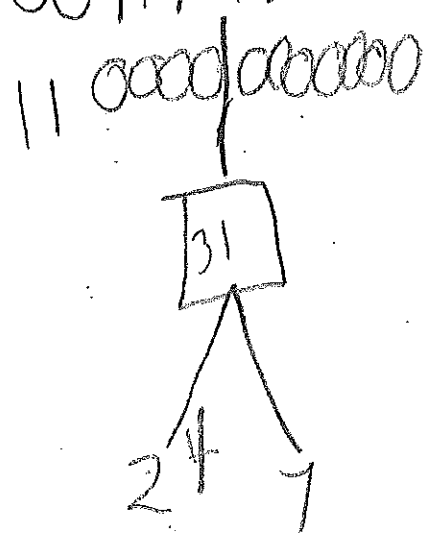

kimberly

Sherly saw 24 frogs. Marissa saw 7 more frogs. How many frogs are all? There 16

$8 + \square = 16$

8 dogs ran away. There 16 dogs altogether. How many are still there?

15+7 = 22

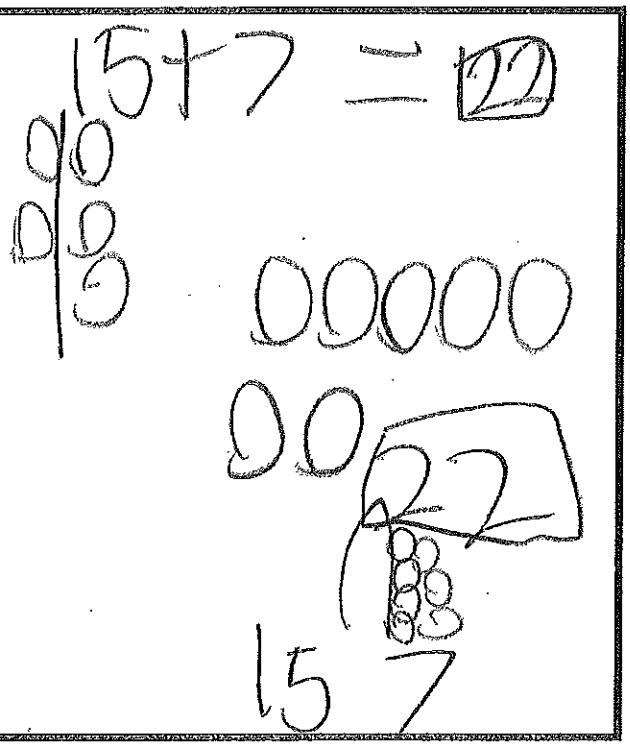

Tadeo saw 15 frogs. Eduardo saw 7 more frogs. How many frogs are all together?

13 + 9 = 12

Eduardo saw 9 speed racers. Tadeo saw some speed racers.

speed racers did Tadeo saw?

$24 + 7 = \boxed{31}$



Sherlyn Saw 24 frogs. Marissasaw 7 more frogs. How many frogs are in all?

$8 + \boxed{8} = 16$

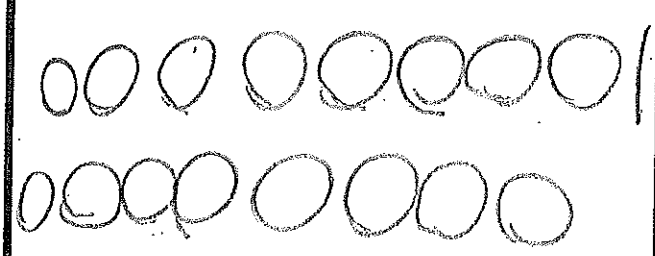

8 dogs ran away. Ther are 16 dogs alltogether. How many are still there?

Adrian

15 + 7 = 22

Demonica
hat 7
Pebbe
now Tania wat
15 DIME

3 + 9 = 12

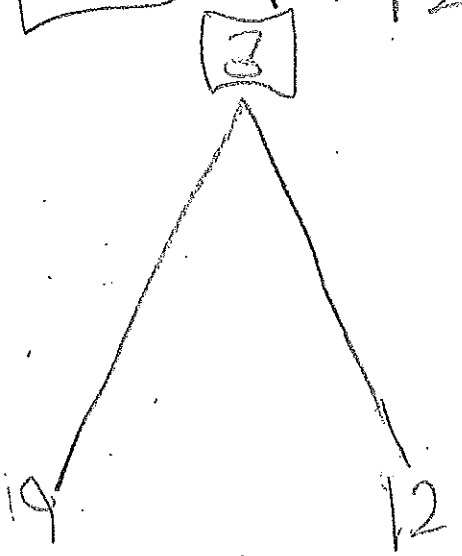

1 Saw 9 Pets
Tania Demonica
2 How many
Pets are all
together

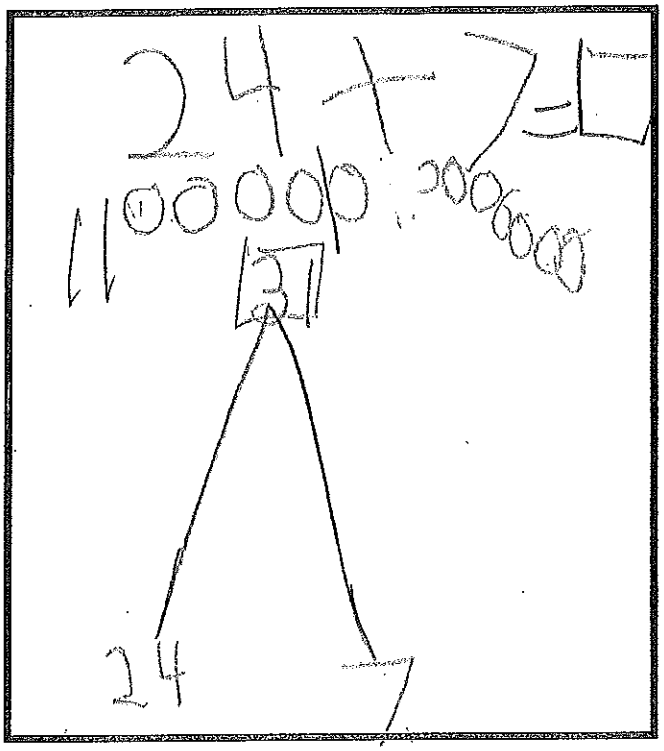

Sherlyn saw 24 frogs. Mathisa saw 7 more frogs. How many frogs are in all?

8 + □ = 16

8 Does Man Otway. There are 16 dogs all together. How many are still there?

15 + 7 = 22

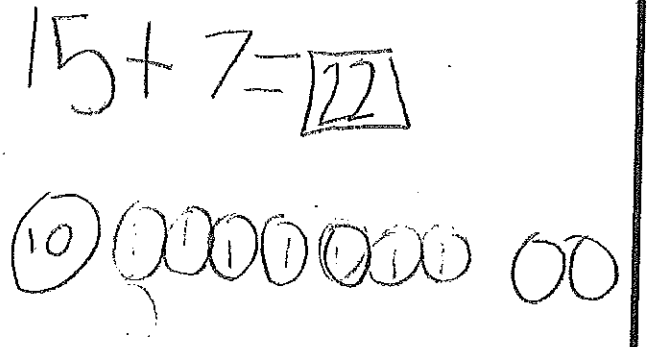

Emily hads 15 Flavrsof ice crem. Monsrrat has 7 flavrs How many in all?

3 + 9 = 12

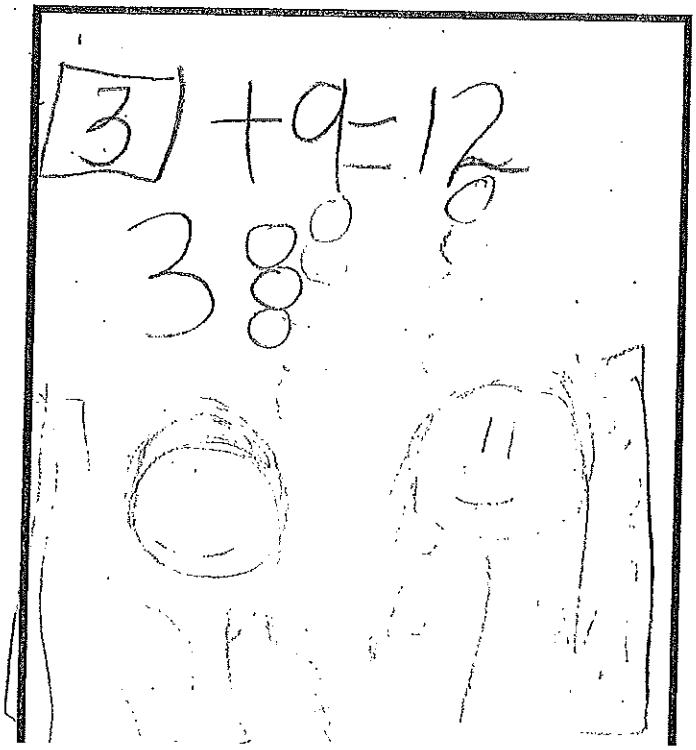

Monsrrat Saw 9 canys. and Emily Saw 12 canys. How many are in all?

$24 + 7 = \boxed{31}$

118 | 0000

8 | $\boxed{31}$

24 7

Sherlyn Saw 24 frogs. Marissa Saw 7 more frogs How many frogs are in all?

$8 + \square = 16$

8 Dogs ran away. There are 61 dog. all together. How many are still there?

15+7=22

15 ○○○○○|○○

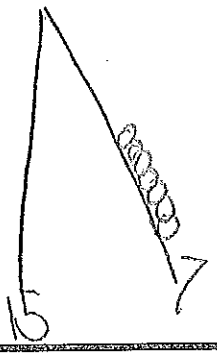

Sharlyn saw 15 cats at a park. Jordan saw 7 cats all together. How many cats do I have all together?

3+9=12

9 ○○○12

3 ○○○○○○|○○○12

Jordan saw 9 race-car at a race. Sharlyn saw 12 more race car came. But where are the rest?

24+7=31

24 ooooooo



Sherlyn saw 24 frogs. Marissa saw 7 more frogs. How many frogs are in all?

8+8=16

8 8 8 8 8 8 8 8 8 8 8 8 8 8 8 8

8 dogs ran away. There are 16 dogs all together. How many are still there?

15 + 7 = 22

Ms. Treetop had 15 ice creams.

□ + 9 = 12

Lexi had some bunnies. Leslie had 9 bunnies. We have 12 altogether

Lexi

24+7=31

Sherlyn saw 24 frogs. Marissa saw 7 more frogs. How many frogs in all?

8+□=16

8 dogs ran away. There are 16 dogs altogether. How many are still here?

15 + 7 = 22

Mrs. Treeter saw 15 cats. Dolly saw 7 cats. How many are in all?

3 + 9 = 12



Mr. C saw 9 penni's. Blayton saw 12 penni's. How many are all together?

$24 + 7 = \boxed{31}$

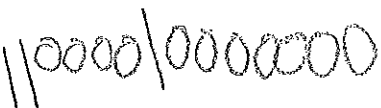

Sherlyn saw 24 frogs. Marissa saw 7 more frogs. How many frogs are in all?

$8 + \boxed{8} = 16$

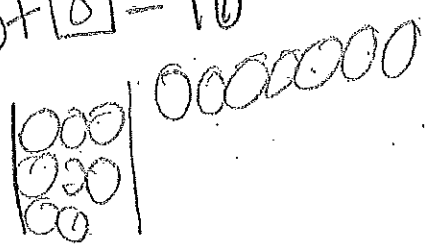

8 dogs ran away. ther are 16 dogs all together. How many are still there?

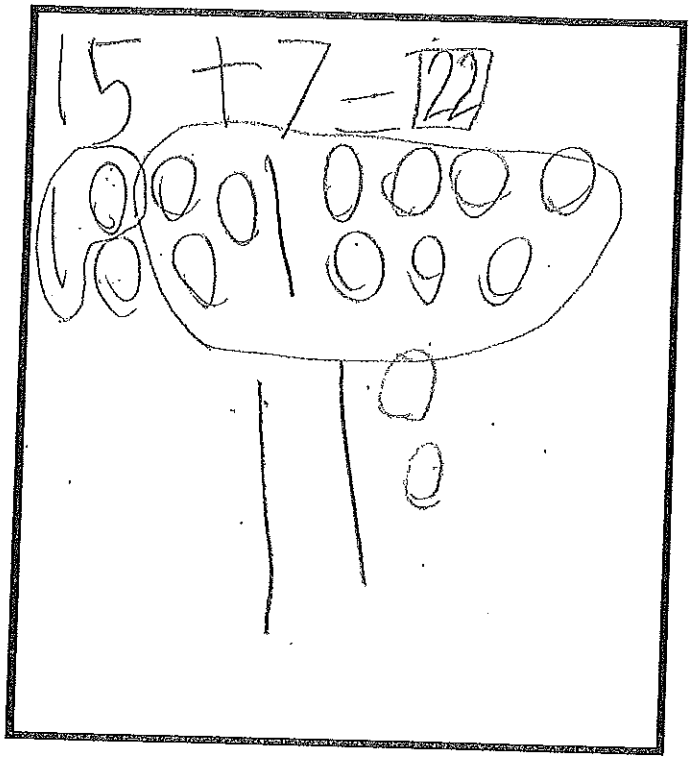

Ms. treeter
sow 15 cat.
Dolly sow 7
cats How many
in all.

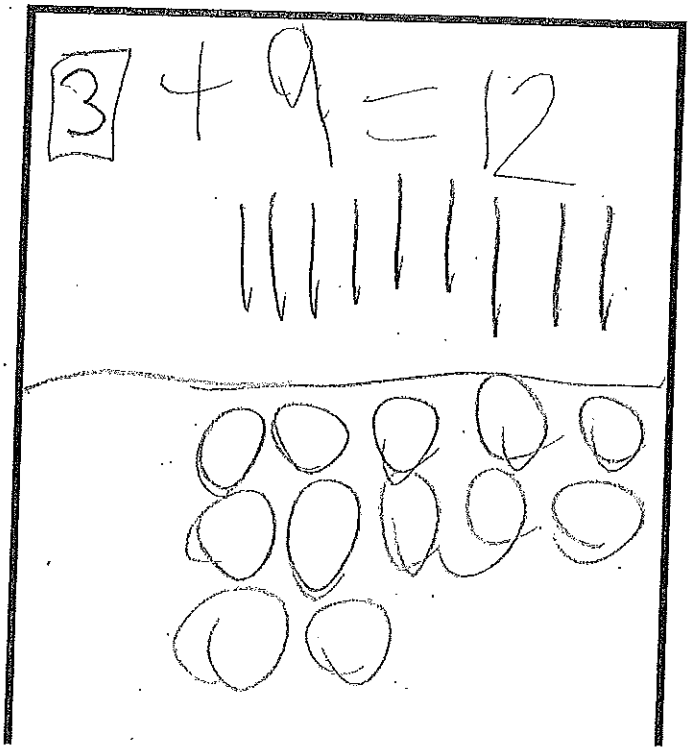

Mr. C sou 9
Pineus ON The
gan Blayton
sou 12 Pineus
Wut nau Wut
all to gf the.

24+7=31



sherlyn saw 24 frogs. Marissa saw 7 more frogs. How many frogs are in all?

8+14=16

8 Dog ran away. There are 16 dogs altogether. How many are still there?

Name

15 + 7 = 22

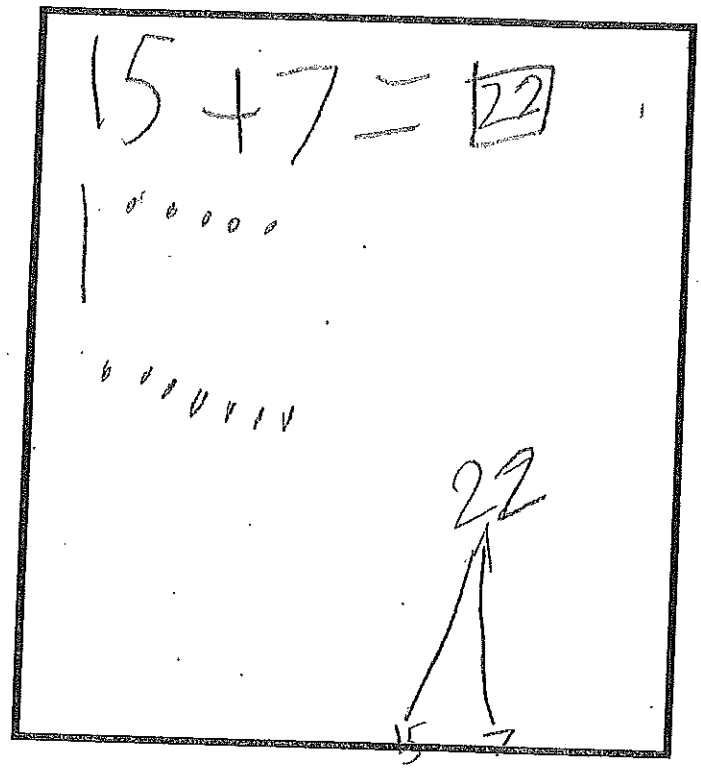

Ms. Treer had 15 ice cremons, Lexi had 7 How many are all?

13 + 9 = 12



Lexi had some Bunnies. Leslie had 9 Bunnies. How many are all?

Leslie

$24 + 7 = \boxed{31}$

110000

0 0 0 0 0 0 0

31

24 7

Sherlyn saw 24 fogs. Marissa saw 7 more fogs. How many frogs are in air?

$8 + \square = 16$

8 dogs fan away. There are 16 dogs altogether. How many are still there?

15 + 7 = 22

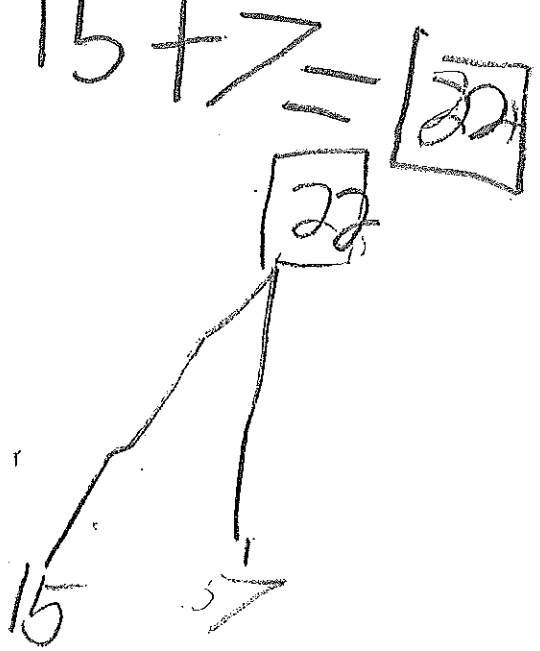

Marissa saw 15 rings and Allison saw 7 more. How many in all?

□ + 9 = 12

Allison saw some owls. Tyler saw 9 foxes. They saw 12 animals?

Marissa





15 + 7 = □



Marissa saw 15 rigs and Allisin saw 7 more. How many in all?

□ + 9 = 12

Allisin saw fox ther saw 9 foxs. ther saw





Sherlyn saw 15 cats at a park. Jordan saw 7 more all together. How many cats do I have all together?

$15 + 7 = \boxed{22}$

15 oooooooo

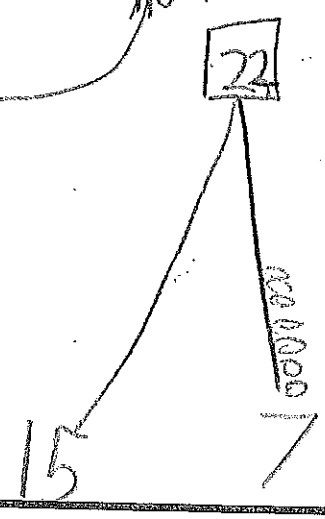

Jordan saw a race cars at a race. Sherlyn saw 12 more race-car came. But where are the rest?

$\boxed{3} + 9 = 12$

9 oooooo oooooooo





15+7=22

(10)

EMily has 15 Flavor icecrem. Monserrat has 17 Flavor icecrem How maney are all togthe?

37+9=12

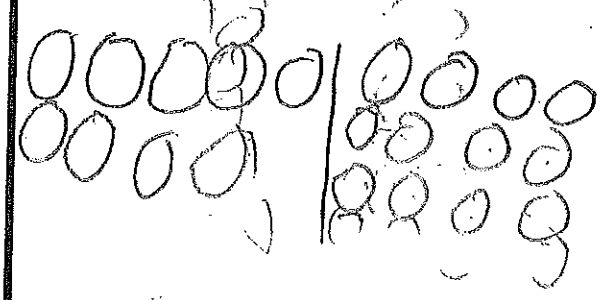

Monserrat saw 9 canys Emily Emaily saw 12 canys on the stor and how Maney are laft?





15 + 7 = 22



Demonica hat 7 Plenns now Tania hat 15. Dime How many How many gtergerdr 22. all to:

3

3 9 = 12

0000
00000
00000



i Saw 9 Pets Tania Demonica 3 How many to all togner Pets.

8



9



15+7=22



Tadeo saw 15 Frogs. Eduardo saw 7 more F Frogs. How many Frogs are al tog there?

13+9=12

Eduardo saw 9 speedracers Tadeo saw same speedracers. there are tog there speedracers. How did Tadeo count?

24 + 7 = 31



Sherlyn saw 24 Frogs. Marissa saw 7 more Frog How many Frog are in all?

8 + 8 = 16

8 dogs ran away. There are 16 dogs al together. How many are still there?

15 + 7 = 22

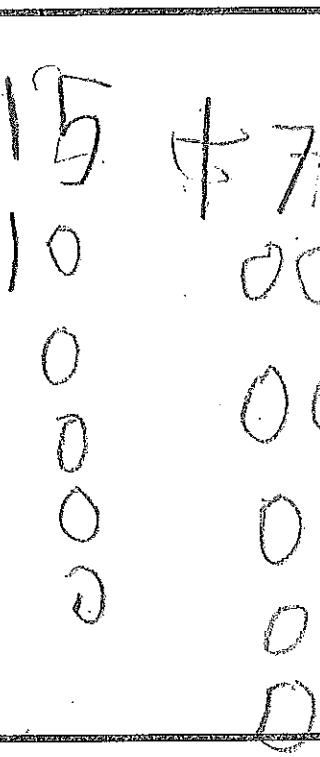

10 00

0 00

0

0 0

0 0

0

I saw 15 snomen 7 more snowmen came. how many are in all together

3 + 9 = 12

I saw 22 baskets. Kimberly saw 12 baskets we added more stars